Dividing with a Numberline

Name:

Use the numberline to solve each problem.

1) 35÷7=

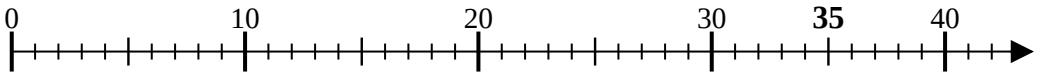

2) 21÷7=

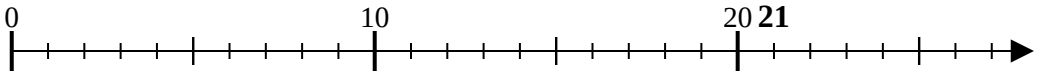

3) 12÷6=

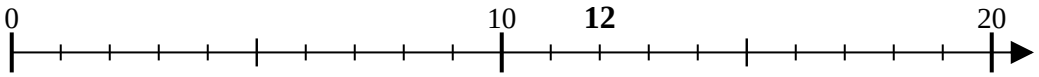

4) 6÷2=

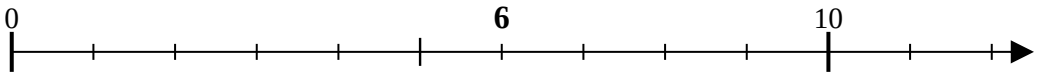

5) 8÷4=

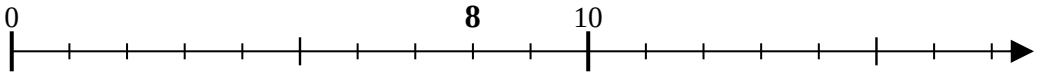

6) 10÷2=

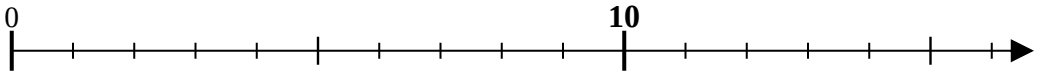

7) 18÷6=

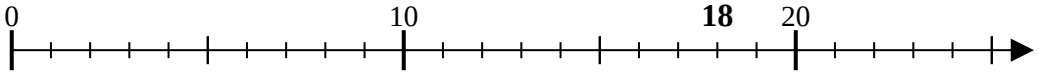

8) 45÷9=

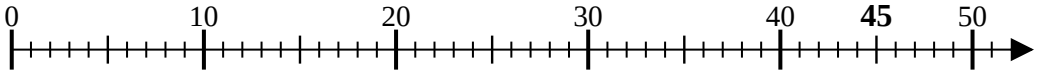

9) 10÷5=

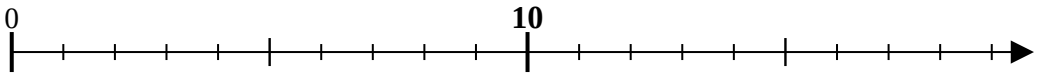

10) 18÷9=

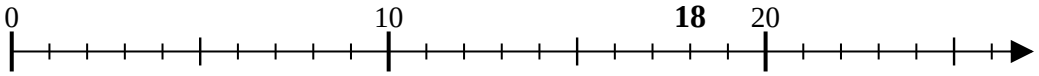

11) 24÷6=

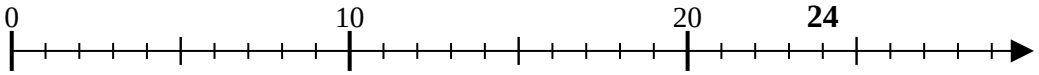

Answers

1. _____
2. _____
3. _____
4. _____
5. _____
6. _____
7. _____
8. _____
9. _____
10. _____
11. _____

1-10	91	82	73	64	55	45	36	27	18	9
11	0									

Dividing with a Numberline

Name: **Answer Key**

Use the numberline to solve each problem.

1) 35÷7=

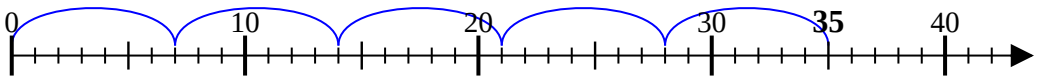

2) 21÷7=

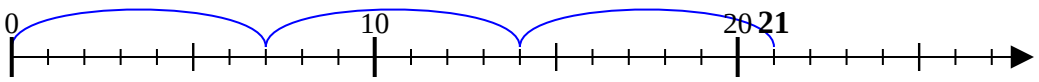

3) 12÷6=

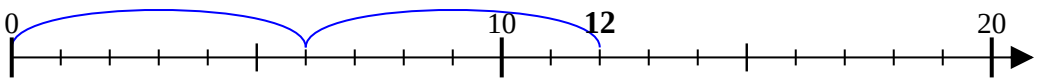

4) 6÷2=

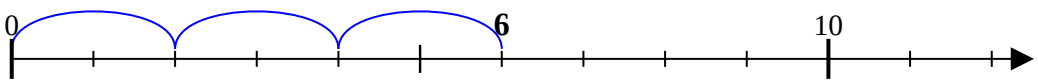

5) 8÷4=

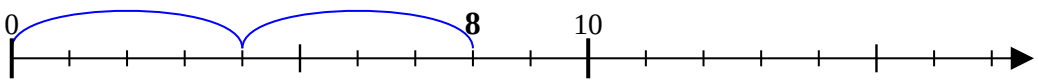

6) 10÷2=

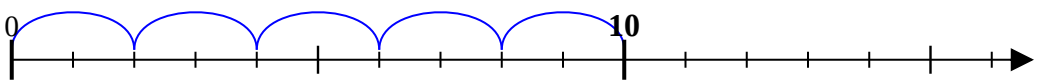

7) 18÷6=

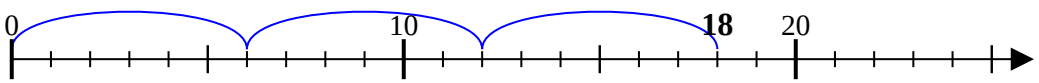

8) 45÷9=

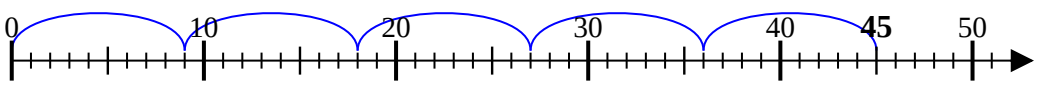

9) 10÷5=

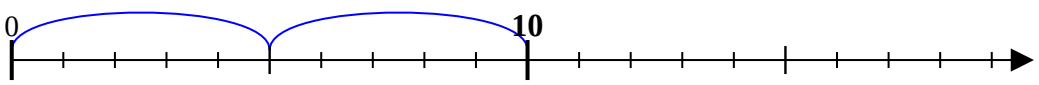

10) 18÷9=

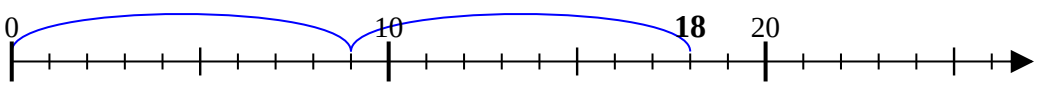

11) 24÷6=

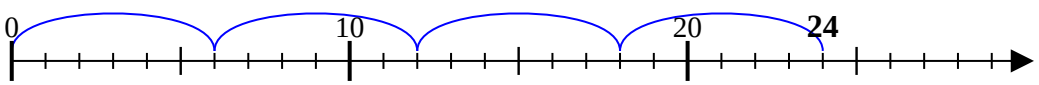

Answers

1. 5
2. 3
3. 2
4. 3
5. 2
6. 5
7. 3
8. 5
9. 2
10. 2
11. 4

1-10	91	82	73	64	55	45	36	27	18	9
11	0									